Graphing Complex Numbers

Name:

Date:

Graph each number in the complex plane.

1) $-3 + 2i$

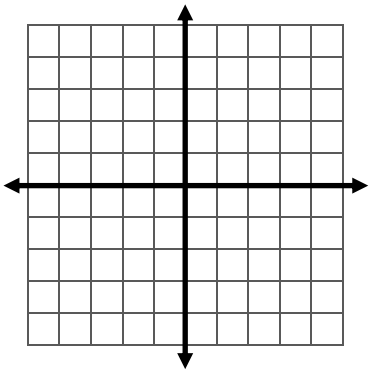

2) $2 + 2i$

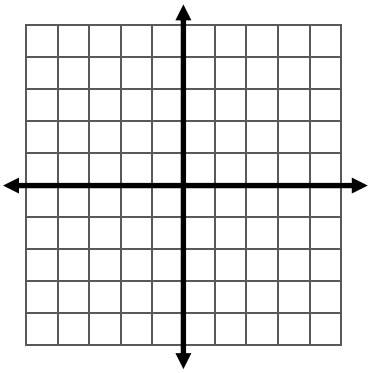

3) $1 - 3i$

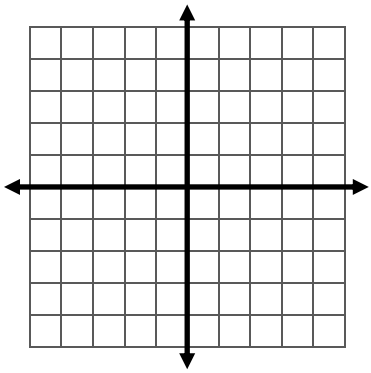

4) $2 - 4i$

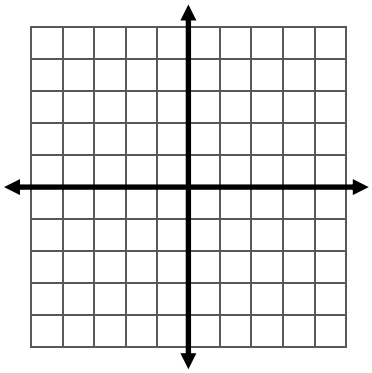

5) $-2 + 5i$

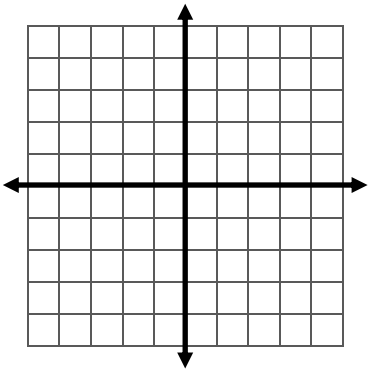

6) $4 + 4i$

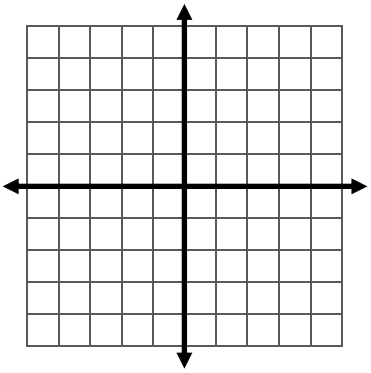

testinar.com/qry8

QUIZ ?

So Much More Online! Please visit: testinar.com

MORE ?

testinar.com/qr2d

Graphing Complex Numbers

Name:

Date:

Answers

Graph each number in the complex plane.

1) $-3 + 2i$

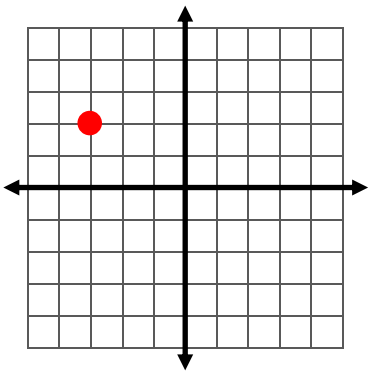

2) $2 + 2i$

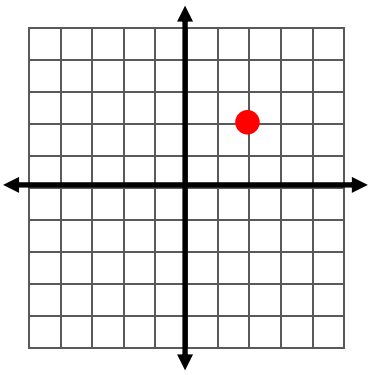

3) $1 - 3i$

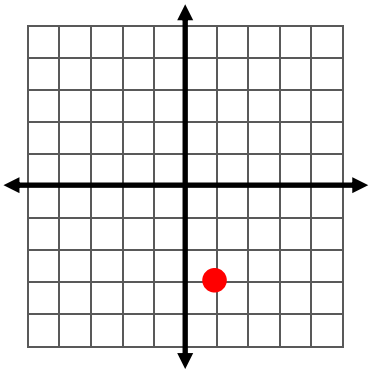

4) $2 - 4i$

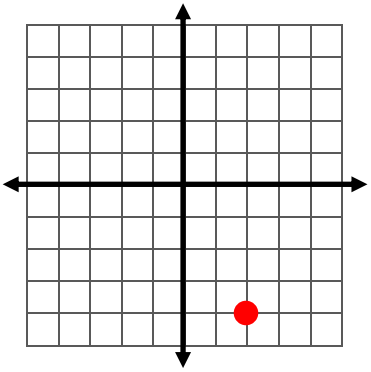

5) $-2 + 5i$

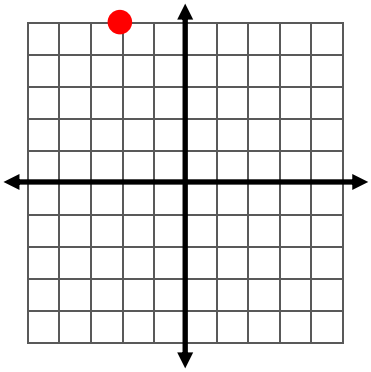

6) $4 + 4i$

