Name:

Date:

Sketch Each Angle in Standard position

Draw the angle with the given measure in standard position.

1) $-280°$



2) $\frac{8\pi}{12}$



3) $160°$



4) $\frac{7\pi}{4}$



5) $\frac{5\pi}{3}$



6) $115°$



7) $-780°$



8) $-\frac{7\pi}{4}$



QUIZ ?

So Much More Online! Please visit: testinar.com

MORE ?

Name:

Date:

Sketch Each Angle in Standard position

Answers

Draw the angle with the given measure in standard position.

1) $-280°$:

$\alpha = 80°$

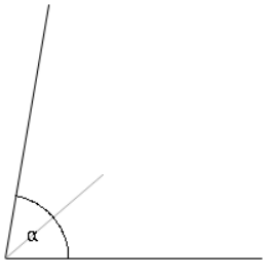

2) $\frac{8\pi}{12}$:

$\alpha = 120°$

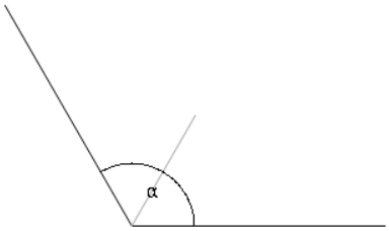

3) $160°$:

$\alpha = 160°$

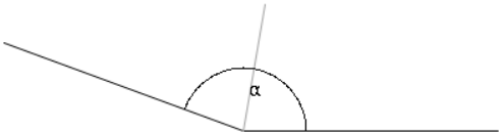

4) $\frac{7\pi}{4}$:

$\alpha = 315°$

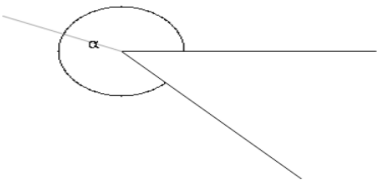

5) $\frac{5\pi}{3}$:

$\alpha = 300°$

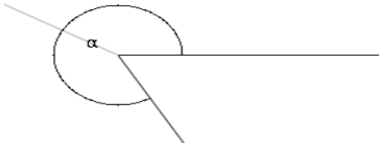

6) $115°$:

$\alpha = 115°$

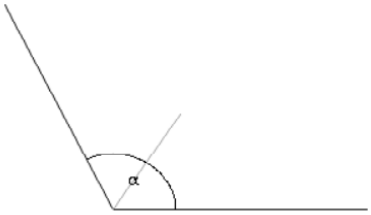

7) $-780°$

$\alpha = 300°$

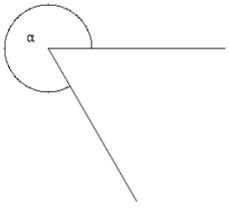

8) $-\frac{7\pi}{4}$

$\alpha = 45°$

