Name:

Date:

Area of Squares, Rectangles, and Parallelograms

Find the area of each.

1)



2)

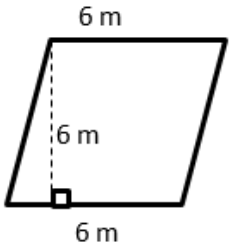

3)

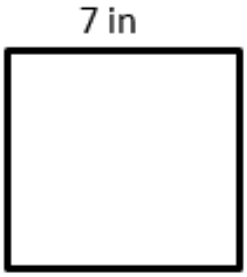

4)

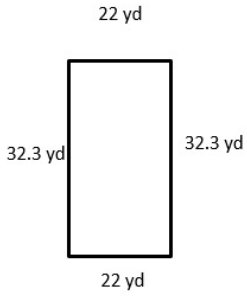

5)

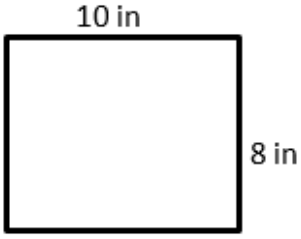

6)

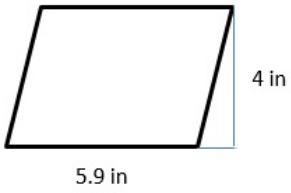

7)

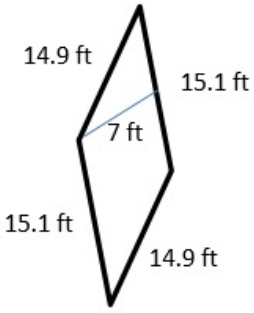

8)

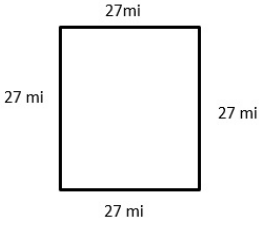

Answer Key - www.testinar.com

Scan me for more PRACTICE

testinar.com/t/?c=14

1)



35 **km**^{2}

2)

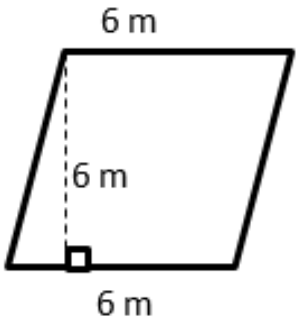

36 **m**^{2}

3)

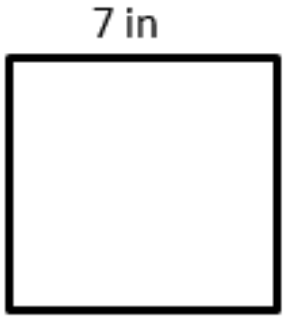

49 **in**^{2}

4)

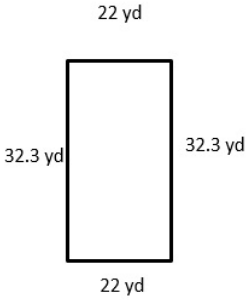

710.6 **yd**^{2}

5)

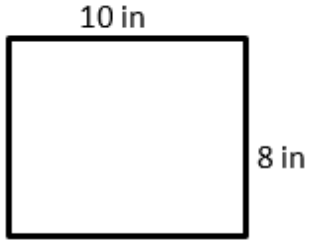

80 **in**^{2}

6)

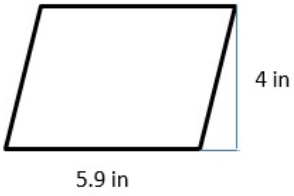

23.6 **in**^{2}

7)

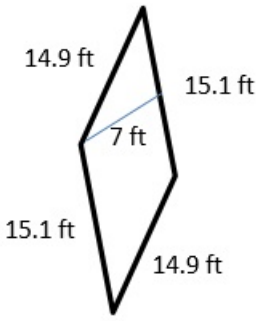

105.7 **ft**^{2}

8)

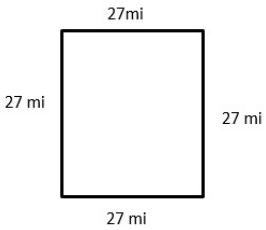

729 **mi**^{2}