Name:

Date:

Graphing Linear Inequalities

Sketch the graph of each linear inequality.

1) $6x - 2y \geq 8$

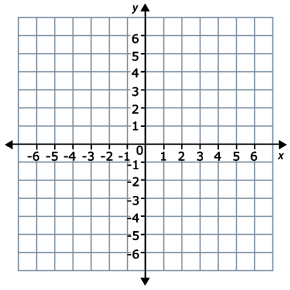

2) $y > 3x - 1$

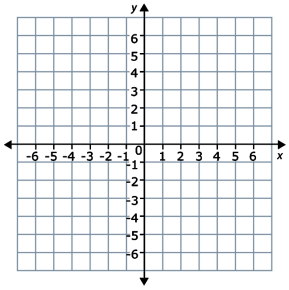

3) $x - 3y < -5$

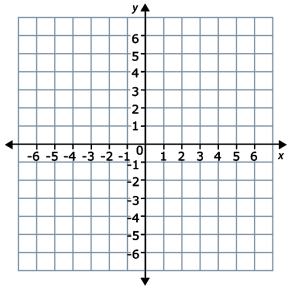

4) $2x + y < -4$

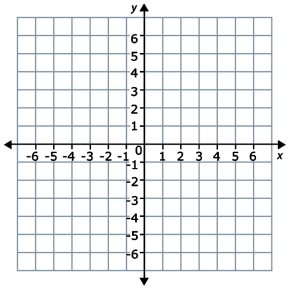

5) $y < -4x + 2$

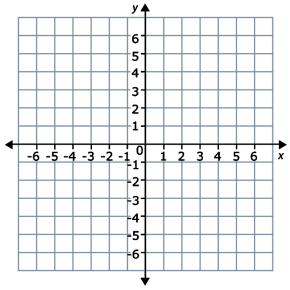

6) $y \leq -5x + 8$

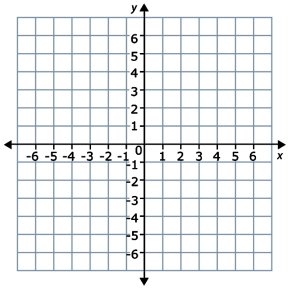

7) $y < -x + 4$

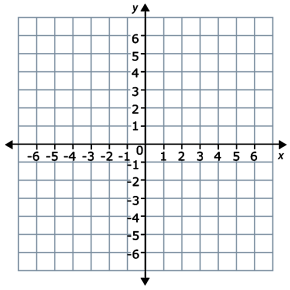

8) $2y \geq 8 + 6x$

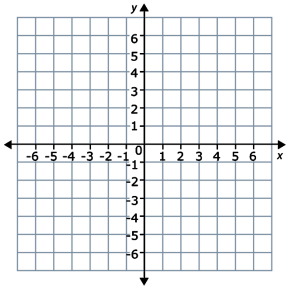

9) $4y \leq -6x + 2$

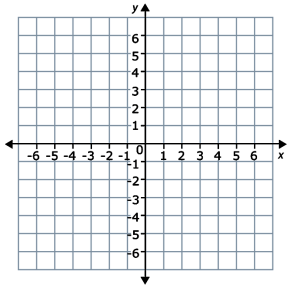

10) $y < 2x - 3$

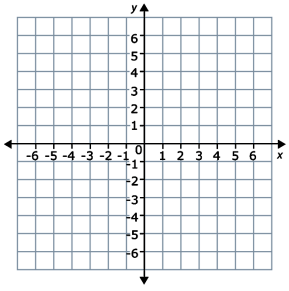

Answer Key - www.testinar.com

Scan me for more PRACTICE

testinar.com/t/?c=9

1) $6x - 2y \geq 8$

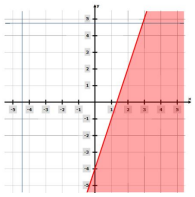

2) $y > 3x - 1$

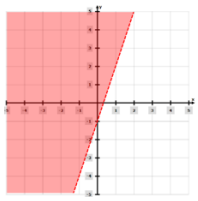

3) $x - 3y < -5$

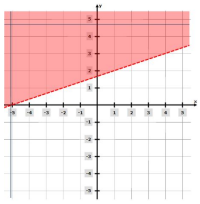

4) $2x + y < -4$

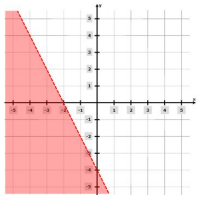

5) $y < -4x + 2$

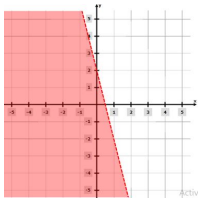

6) $y \leq -5x + 8$

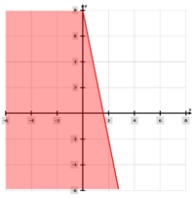

7) $y < -x + 4$

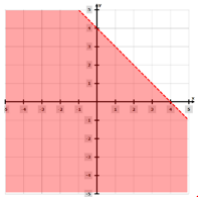

8) $2y \geq 8 + 6x$

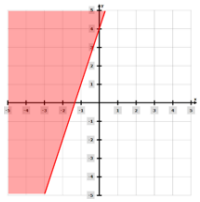

9) $4y \leq -6x + 2$

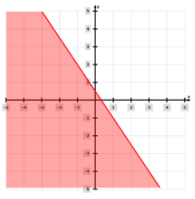

10) $y < 2x - 3$

