One Step Inequalities

testinar.com/t/?c=8

Draw a graph for each inequality.

1) $21x \leqslant 42$

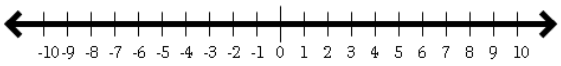

2) $1 + x \leqslant 1$

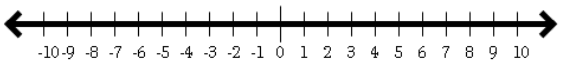

3) $18x > 18$

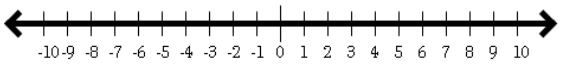

4) $18x < 18$

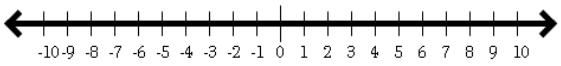

5) $13x \leqslant 65$

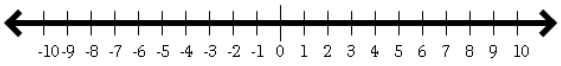

6) $10x \leqslant 80$

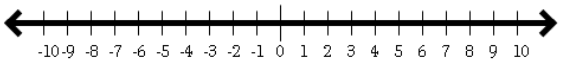

7) $3 + x < 1$

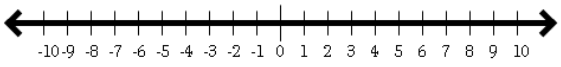

8) $21x < 42$

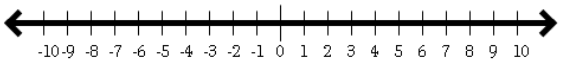

9) $4 \leqslant 6 + x$

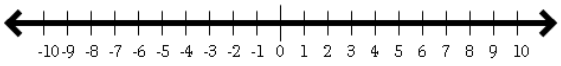

10) $6x \leqslant 30$

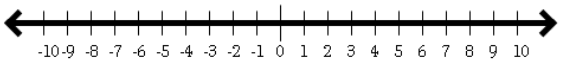

11) $16x \leqslant 80$

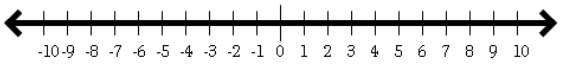

12) $2 + x < 6$

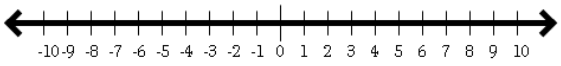

13) $9x \leqslant 45$

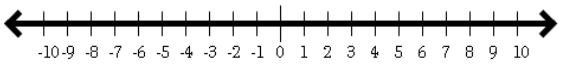

14) $11x > 66$

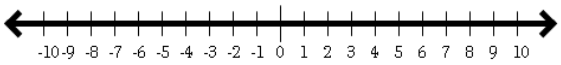

15) $5x \leqslant 10$

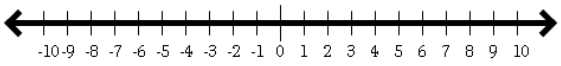

16) $0 \leqslant 4 + x$

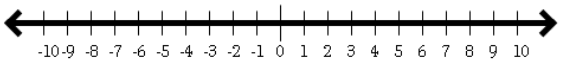

Answers of One Step Inequalities

Draw a graph for each inequality.

1) $21x \leqslant 42$

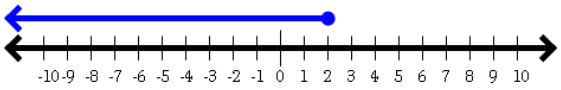

2) $1 + x \leqslant 1$

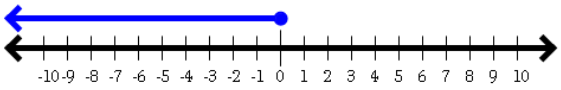

3) $18x > 18$

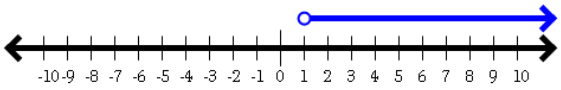

4) $18x < 18$

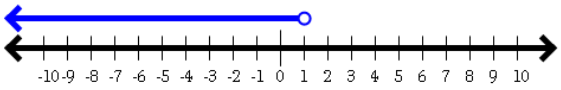

5) $13x \leqslant 65$

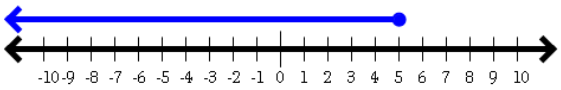

6) $10x \leqslant 80$

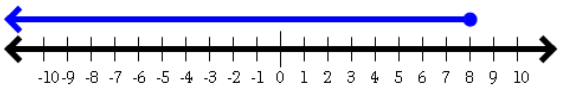

7) $3 + x < 1$



8) $21x < 42$

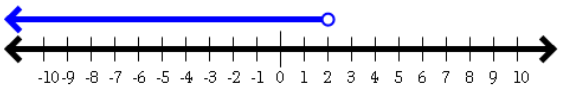

9) $4 \leqslant 6 + x$

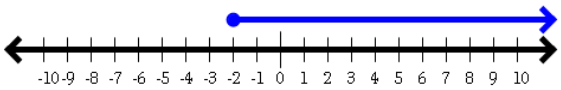

10) $6x \leqslant 30$

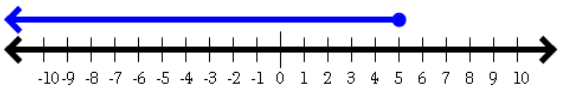

11) $16x \leqslant 80$

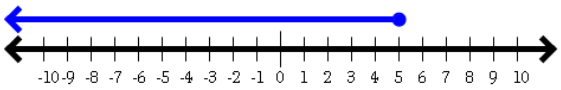

12) $2 + x < 6$

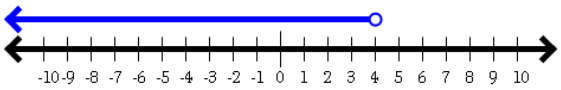

13) $9x \leqslant 45$

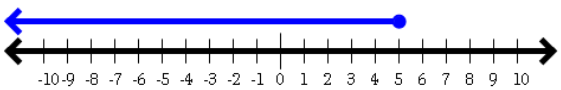

14) $11x > 66$



15) $5x \leqslant 10$

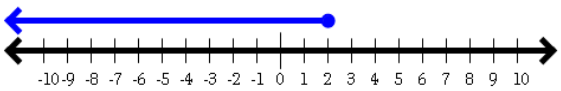

16) $0 \leqslant 4 + x$

