Two Step Inequalities

testinar.com/t/?c=8

Draw a graph for each inequality.

1) $5x + 4 \geqslant 29$

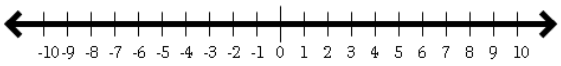

2) $-6x + 15 \geqslant -3$

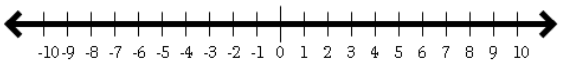

3) $3x + 16 \geqslant 37$

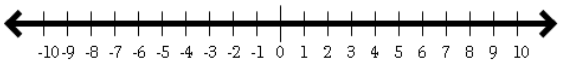

4) $-9x + 9 < -63$

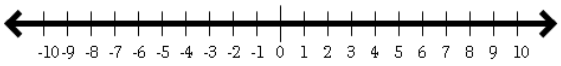

5) $7x + 6 \geqslant 41$

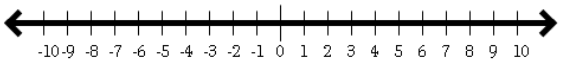

6) $4x + 2 \leqslant 14$

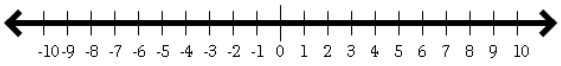

7) $6x + 1 \geqslant 43$

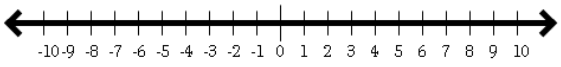

8) $-7x + 12 < -23$

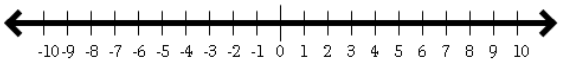

9) $-5x + 3 \geqslant -2$

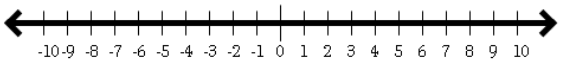

10) $5x + 9 \geqslant 49$

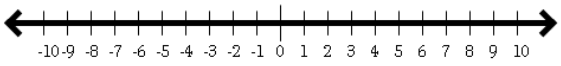

11) $7x + 6 \leqslant 13$

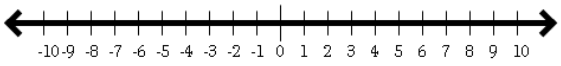

12) $-3x + 2 > -10$

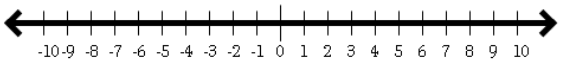

13) $2x + 7 \leqslant 15$

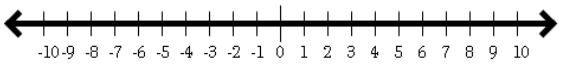

14) $-6x + 4 > -44$

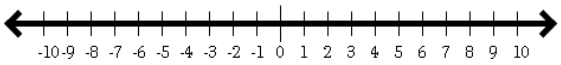

15) $-5x + 1 > -4$

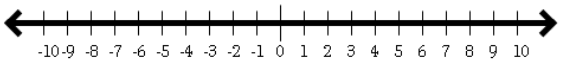

16) $-9x + 10 \leqslant -35$

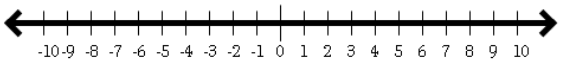

Answers of Two Step Inequalities

Draw a graph for each inequality.

1) $5x + 4 \geqslant 29$



2) $-6x + 15 \geqslant -3$

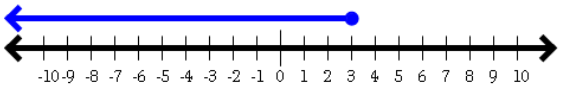

3) $3x + 16 \geqslant 37$



4) $-9x + 9 < -63$



5) $7x + 6 \geqslant 41$

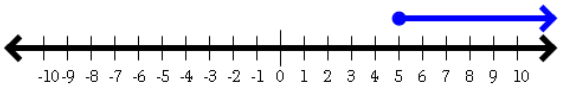

6) $4x + 2 \leqslant 14$

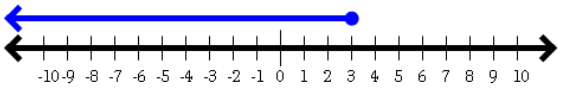

7) $6x + 1 \geqslant 43$



8) $-7x + 12 < -23$



9) $-5x + 3 \geqslant -2$

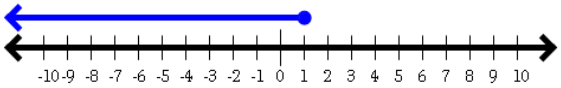

10) $5x + 9 \geqslant 49$



11) $7x + 6 \leqslant 13$

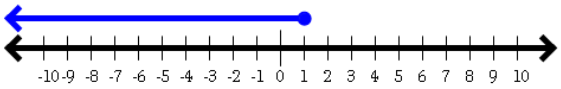

12) $-3x + 2 > -10$

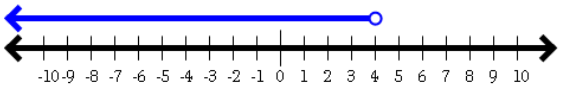

13) $2x + 7 \leqslant 15$

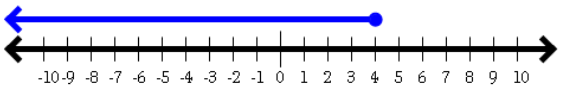

14) $-6x + 4 > -44$

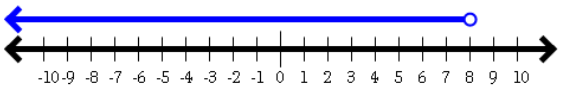

15) $-5x + 1 > -4$

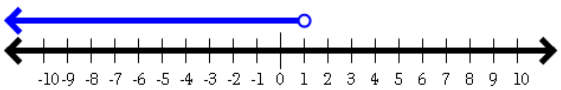

16) $-9x + 10 \leqslant -35$

