Multi Step Inequalities

testinar.com/t/?c=8

Draw a graph for each inequality.

1) $\frac{x-4}{2} \geqslant 0$

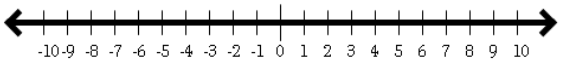

2) $4(x+16) < 92$

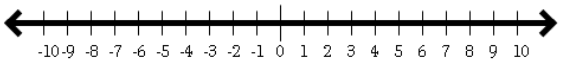

3) $\frac{x-27}{3} \geqslant -7$

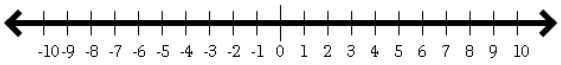

4) $2(x+1) \geqslant 10$

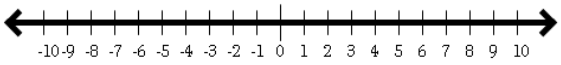

5) $8(x+15) \leqslant 160$

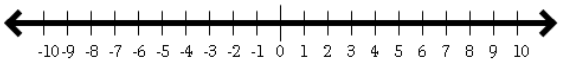

6) $4(x+13) < 84$

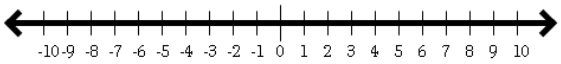

7) $3(x+2) < 27$



8) $6(x+9) \geqslant 96$



9) $\frac{x-20}{4} \geqslant -2$

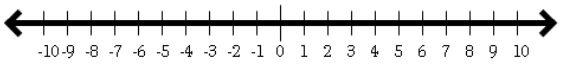

10) $6(x+7) < 90$

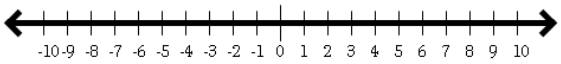

11) $5(x+1) \leqslant 35$



12) $4(x+12) \leqslant 52$



13) $\frac{x-9}{3} \geqslant -3$

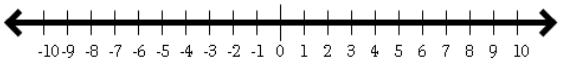

14) $3(x+20) \leqslant 69$



15) $8(x+9) \leqslant 80$



16) $3(x+3) < 33$



Answers of Multi Step Inequalities

Draw a graph for each inequality.

1) $\frac{x-4}{2} \geqslant 0$



2) $4(x+16) < 92$

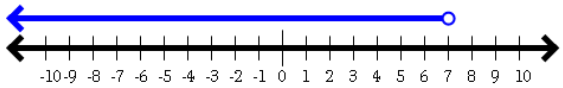

3) $\frac{x-27}{3} \geqslant -7$



4) $2(x+1) \geqslant 10$



5) $8(x+15) \leqslant 160$

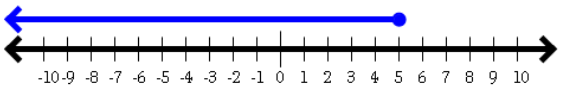

6) $4(x+13) < 84$

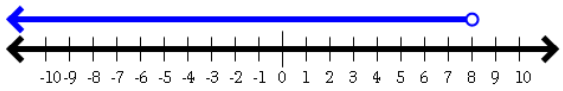

7) $3(x+2) < 27$

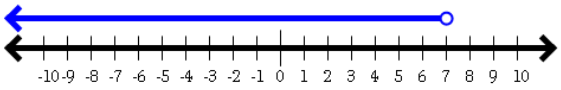

8) $6(x+9) \geqslant 96$



9) $\frac{x-20}{4} \geqslant -2$



10) $6(x+7) < 90$

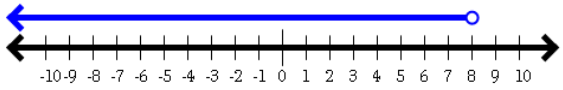

11) $5(x+1) \leqslant 35$

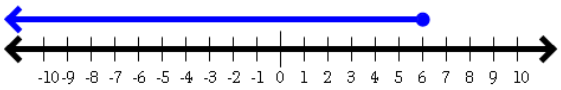

12) $4(x+12) \leqslant 52$

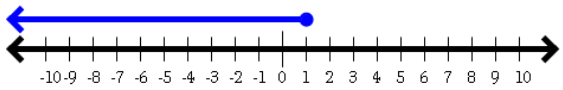

13) $\frac{x-9}{3} \geqslant -3$

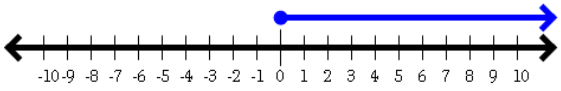

14) $3(x+20) \leqslant 69$

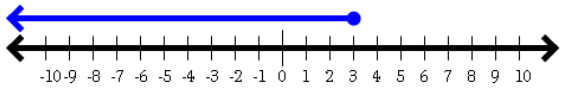

15) $8(x+9) \leqslant 80$

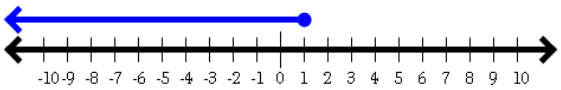

16) $3(x+3) < 33$

