One Step Inequalities

testinar.com/t/?c=8

Draw a graph for each inequality.

1) $8 < 8 + x$

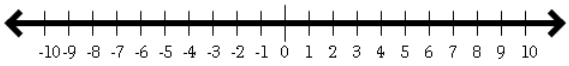

2) $3 \leqslant 2 + x$

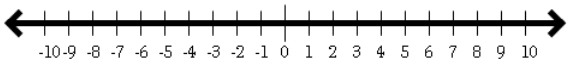

3) $7 + x \leqslant 4$

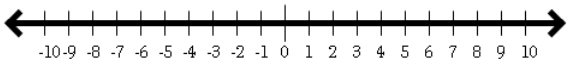

4) $6x \leqslant 30$

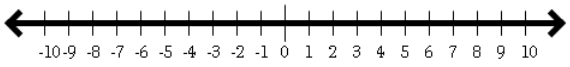

5) $15x > 30$

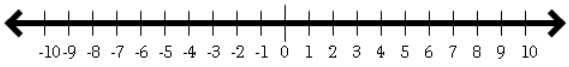

6) $4x \leqslant 32$

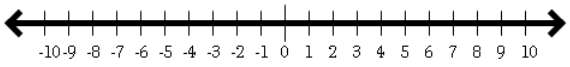

7) $8 + x \leqslant 2$

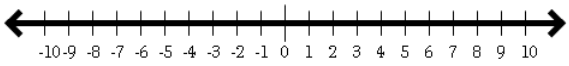

8) $10x \geqslant 50$

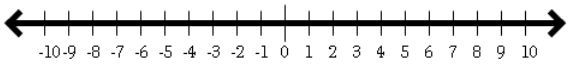

9) $14x < 56$

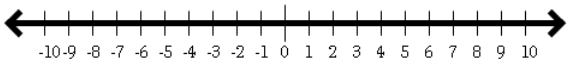

10) $8x \geqslant 8$

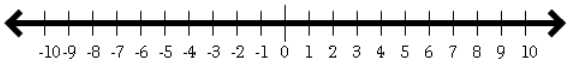

11) $3x < 18$

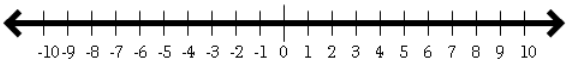

12) $11x \geqslant 33$

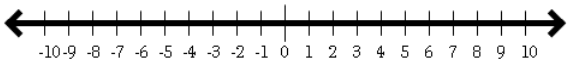

13) $14x > 56$



14) $9x \leqslant 45$



Answers of One Step Inequalities

Draw a graph for each inequality.

1) $8 < 8 + x$

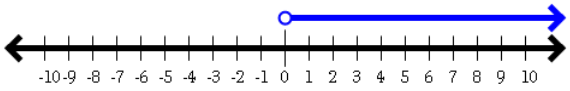

2) $3 \leqslant 2 + x$

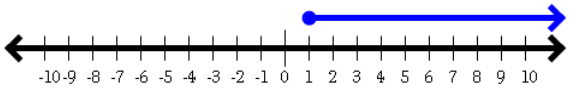

3) $7 + x \leqslant 4$



4) $6x \leqslant 30$

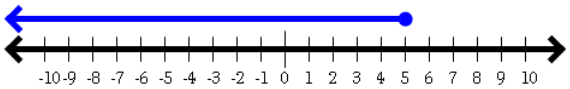

5) $15x > 30$

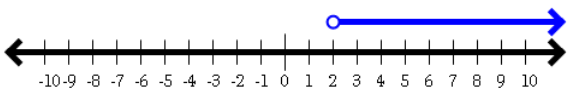

6) $4x \leqslant 32$

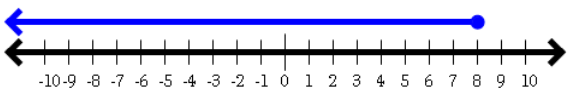

7) $8 + x \leqslant 2$



8) $10x \geqslant 50$



9) $14x < 56$

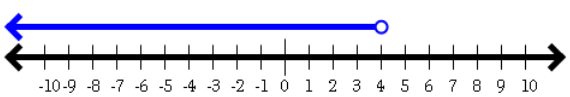

10) $8x \geqslant 8$

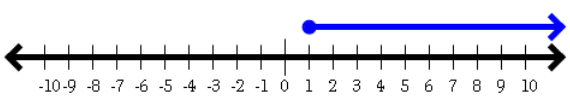

11) $3x < 18$

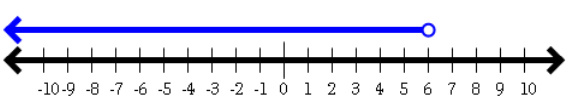

12) $11x \geqslant 33$



13) $14x > 56$

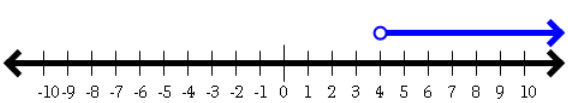

14) $9x \leqslant 45$

