Two Step Inequalities

testinar.com/t/?c=8

Draw a graph for each inequality.

1) $-5x + 6 \leqslant -34$

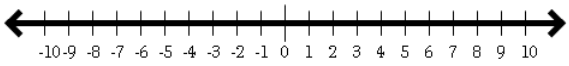

2) $-3x + 19 > 4$

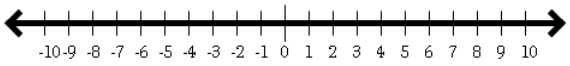

3) $-3x + 10 > -2$

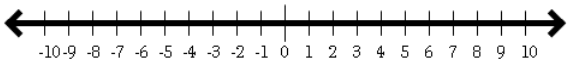

4) $-6x + 7 \geqslant -11$

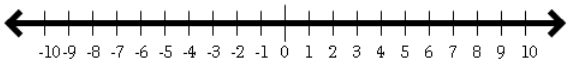

5) $-4x + 7 < 3$

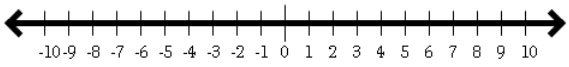

6) $7x + 7 \geqslant 35$

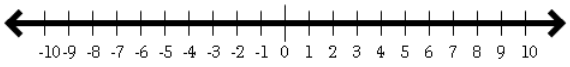

7) $3x + 13 \leqslant 25$

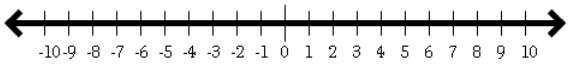

8) $-9x + 5 < -22$

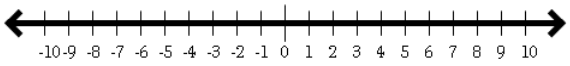

9) $-8x + 17 \leqslant 9$

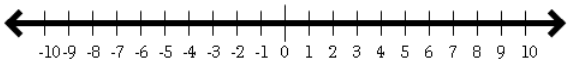

10) $-5x + 3 \geqslant -2$

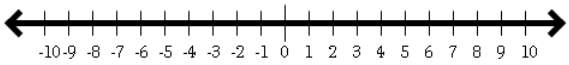

11) $8x + 19 \geqslant 51$

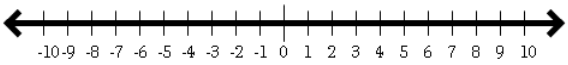

12) $-9x + 18 \leqslant -18$

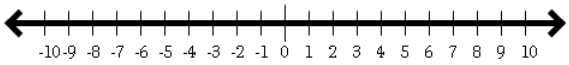

13) $6x + 9 \leqslant 45$



14) $-7x + 7 > -42$

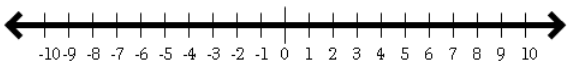

Answers of Two Step Inequalities

Draw a graph for each inequality.

1) $-5x + 6 \leqslant -34$



2) $-3x + 19 > 4$

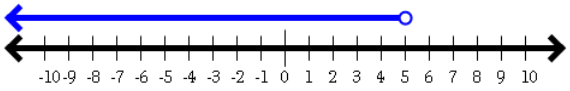

3) $-3x + 10 > -2$

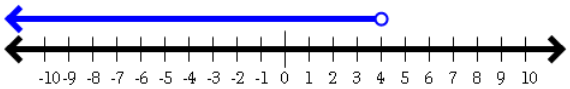

4) $-6x + 7 \geqslant -11$

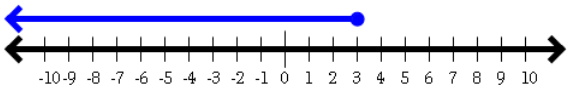

5) $-4x + 7 < 3$

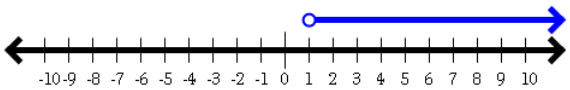

6) $7x + 7 \geqslant 35$



7) $3x + 13 \leqslant 25$

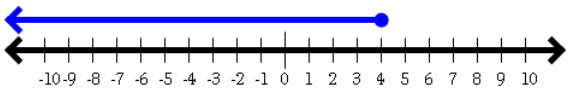

8) $-9x + 5 < -22$



9) $-8x + 17 \leqslant 9$

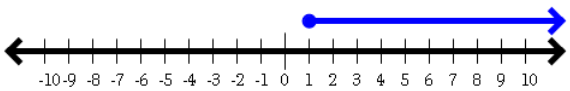

10) $-5x + 3 \geqslant -2$

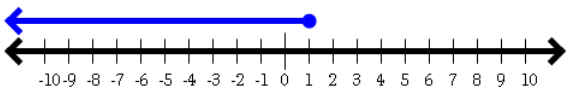

11) $8x + 19 \geqslant 51$



12) $-9x + 18 \leqslant -18$



13) $6x + 9 \leqslant 45$

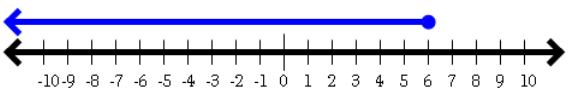

14) $-7x + 7 > -42$

