Multi Step Inequalities

testinar.com/t/?c=8

Draw a graph for each inequality.

1) $8(x + 11) < 136$

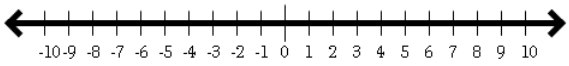

2) $4(x + 2) \leqslant 32$

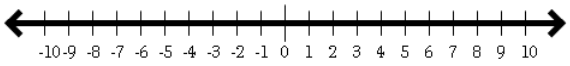

3) $2(x + 19) < 42$

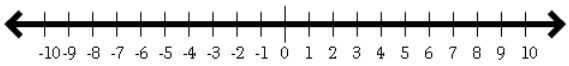

4) $3(x + 6) \leqslant 39$

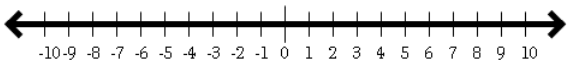

5) $4(x + 9) < 40$

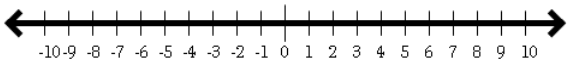

6) $2(x + 1) \geqslant 10$

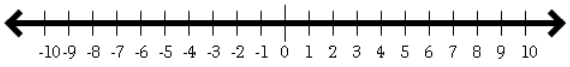

7) $\frac{x-32}{4} \geqslant -8$

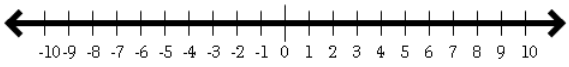

8) $\frac{x-24}{3} \geqslant -8$

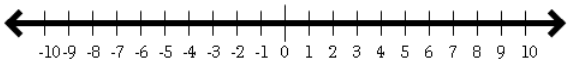

9) $6(x + 2) \geqslant 54$

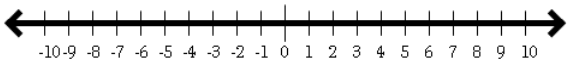

10) $\frac{x-6}{3} \geqslant -2$

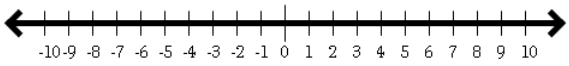

11) $2(x + 3) \geqslant 20$

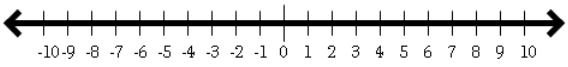

12) $5(x + 4) < 25$

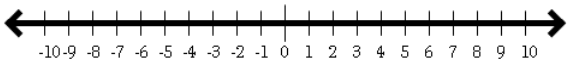

13) $\frac{x-18}{2} \geqslant -7$



14) $7(x + 15) \geqslant 126$



Answers of Multi Step Inequalities

Draw a graph for each inequality.

1) $8(x + 11) < 136$

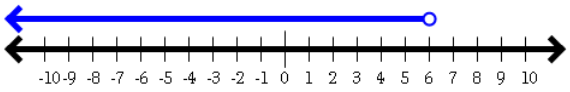

2) $4(x + 2) \leqslant 32$

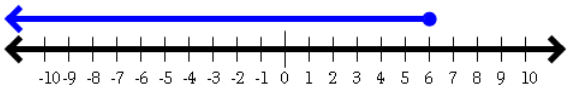

3) $2(x + 19) < 42$

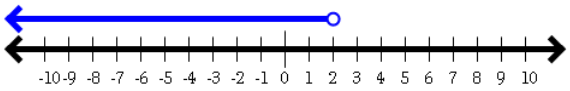

4) $3(x + 6) \leqslant 39$

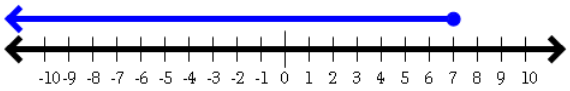

5) $4(x + 9) < 40$

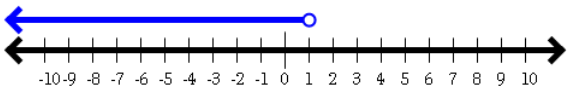

6) $2(x + 1) \geqslant 10$



7) $\frac{x-32}{4} \geqslant -8$

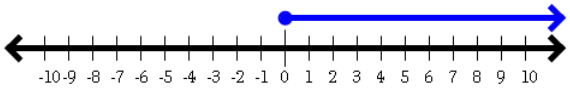

8) $\frac{x-24}{3} \geqslant -8$

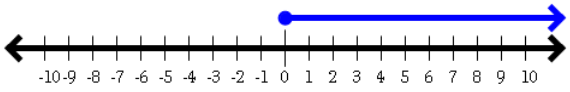

9) $6(x + 2) \geqslant 54$



10) $\frac{x-6}{3} \geqslant -2$

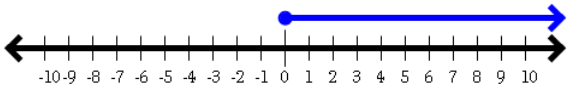

11) $2(x + 3) \geqslant 20$



12) $5(x + 4) < 25$

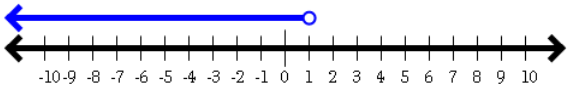

13) $\frac{x-18}{2} \geqslant -7$



14) $7(x + 15) \geqslant 126$

