Name:

Date:

Sketch Each Angle in Standard Position

Draw the angle with the given measure in standard position.

1) -120°



2) $\frac{-10\pi}{3}$

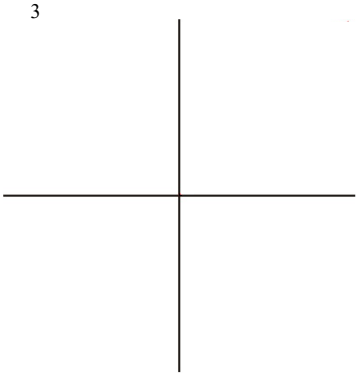

3) 280°



4) 710°



5) 440°

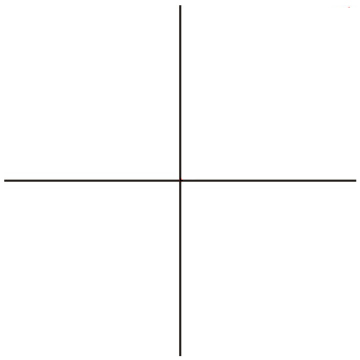

6) $\frac{11\pi}{6}$

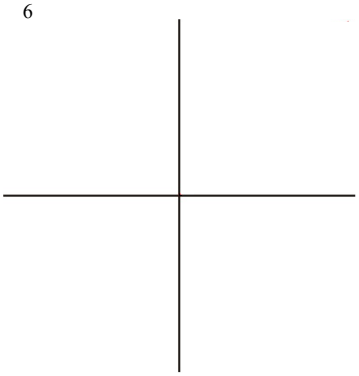

Answer Key - www.testinar.com

Scan me for more PRACTICE

testinar.com/t/?c=21

1) -120°

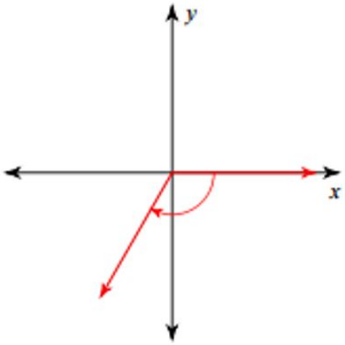

2) $\frac{-10\pi}{3}$

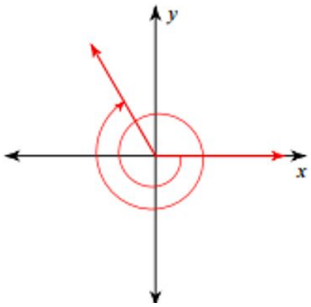

3) 280°

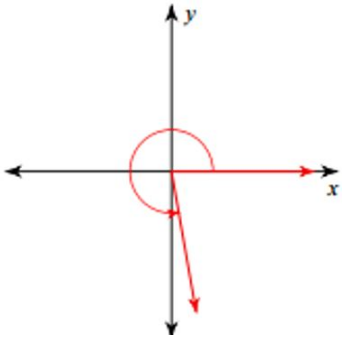

4) 710°

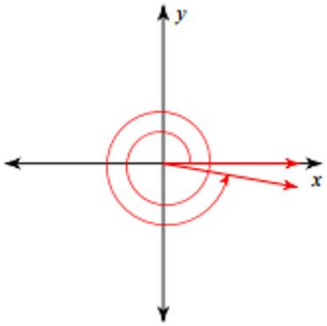

5) 440°

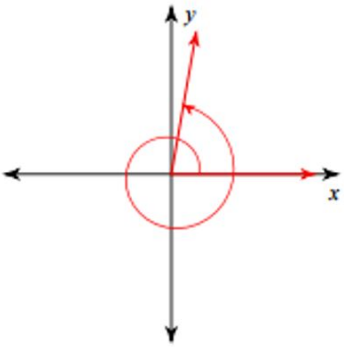

6) $\frac{11\pi}{6}$

