Name:

Date:

Missing Sides and Angles of a Right Triangle

Find the value of each trigonometric ratio as fractions in their simplest form.

1) sin X

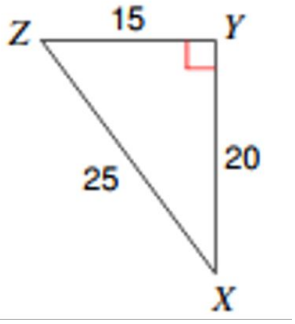

2) tan A

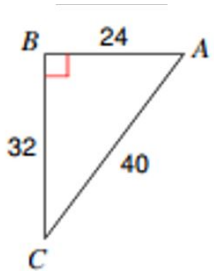

Find the missing side. Round answers to the nearest tenth.

3)

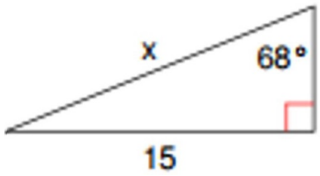

4)



5)

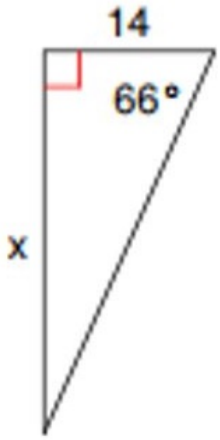

6)

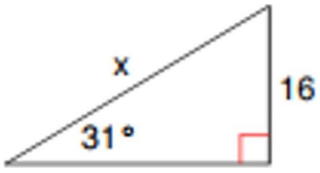

Answer Key - www.testinar.com

Scan me for more PRACTICE

testinar.com/t/?c=21

1) sin X

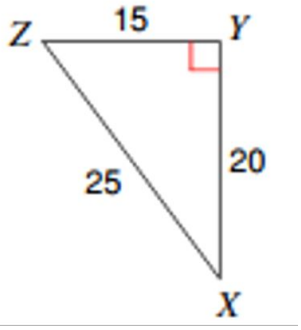

$\frac{3}{5}$

2) tan A

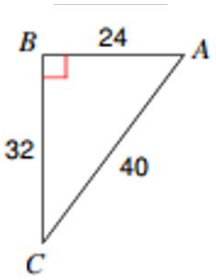

$\frac{4}{3}$

3)

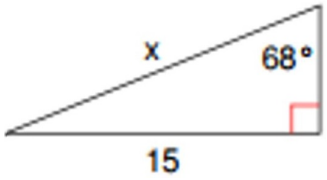

16.2

4)

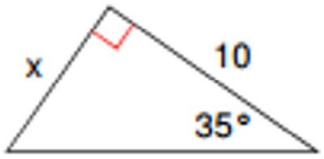

7.0

5)

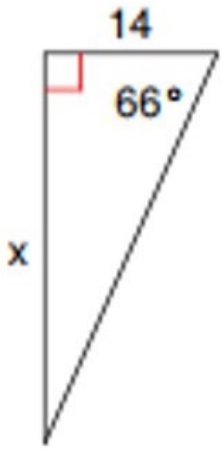

31.4

6)

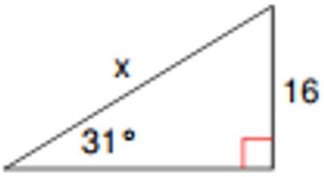

31.1